数学Ⅰ　１年生 学年末考査勉強会その３

年　　組　　号

氏名

■ sin（サイン），cos（コサイン），tan（タンジェント）

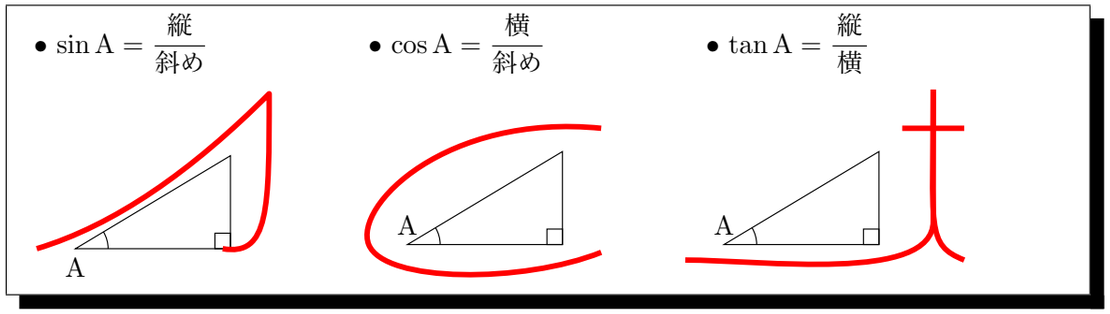

1 三角比の表を使って次の値を調べなさい。

(1) $\sin 4^\circ$　　(2) $\cos 56^\circ$

(3) $\sin 23^\circ$　　(4) $\tan 88^\circ$

(5) $\sin 11^\circ$　　(6) $\cos 39^\circ$

(7) $\tan 73^\circ$　　(8) $\cos 69^\circ$

2 次の直角三角形において，x の値をそれぞれ計算しなさい。

(1)

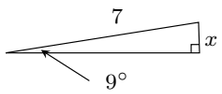

(2)

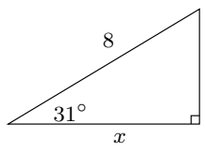

(3)

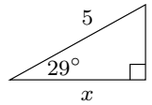

(4)

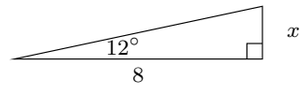

(5)

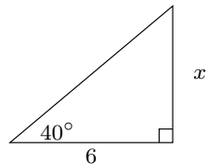

(6)

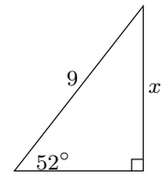

(7)

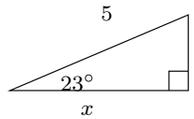

(8)

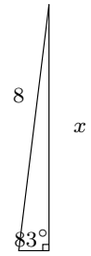

(9)

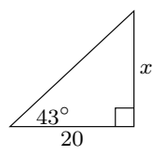
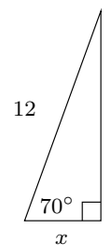
(10)